Name _____ Date _____

Fractions of shapes puzzle no. 1

What fraction of each shape is coloured in?

1

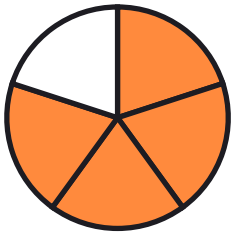

_____

2

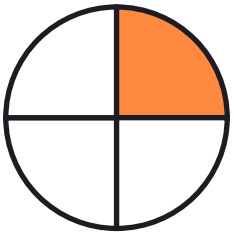

_____

3



_____

4

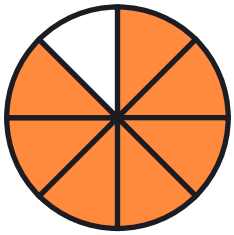

_____

5

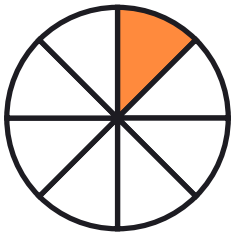

_____

6



_____

7



_____

8



_____

Name _____ Date _____

Answer key: Fractions of shapes puzzle no. 1

What fraction of each shape is coloured in?

1

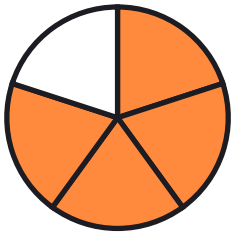

4/5

2

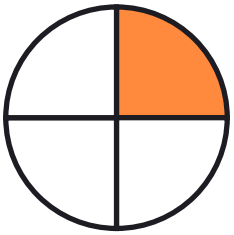

1/4

3



2/3

4

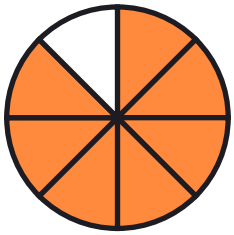

7/8

5

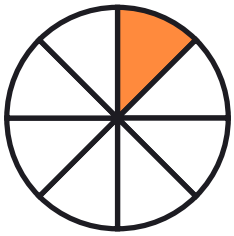

1/8

6



1/2

7



2/5

8



1/5