Name _____ Date _____

Fractions of shapes puzzle no. 10

What fraction of each shape is coloured in?

1

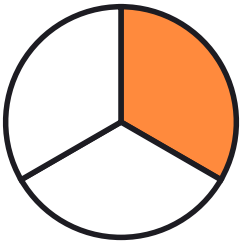

_____

2

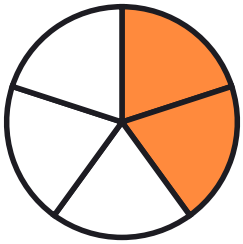

_____

3



_____

4



_____

5

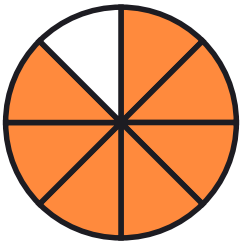

_____

6



_____

7

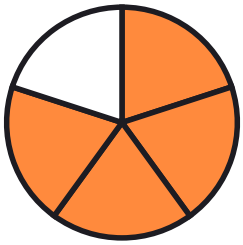

_____

8



_____

Name _____ Date _____

Answer key: Fractions of shapes puzzle no. 10

What fraction of each shape is coloured in?

1

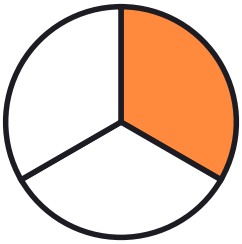

1/3

2

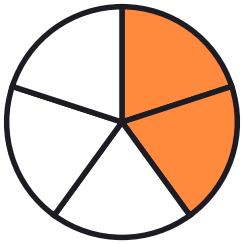

2/5

3



2/3

4



1/3

5

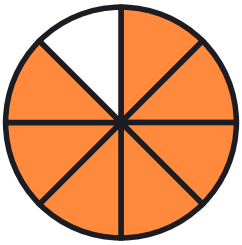

7/8

6



1/2

7

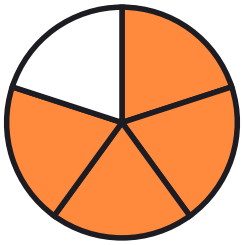

4/5

8



2/3