Name _____ Date _____

# Fractions of shapes puzzle no. 11

What fraction of each shape is coloured in?

1

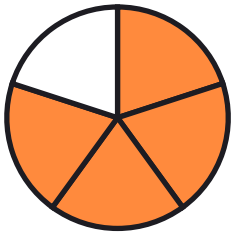

_____

2



_____

3



_____

4



_____

5

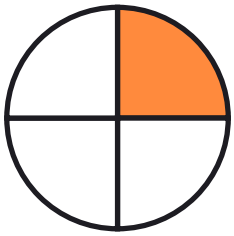

_____

6

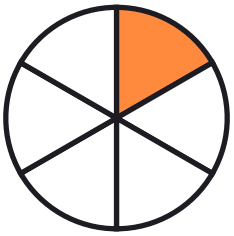

_____

7



_____

8



_____

Name _____ Date _____

# Answer key: Fractions of shapes puzzle no. 11

What fraction of each shape is coloured in?

1

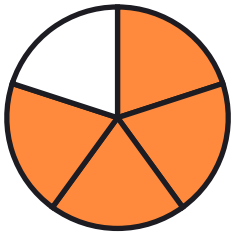

4/5

2



5/6

3



3/4

4



3/4

5

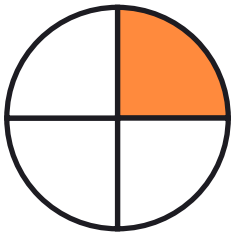

1/4

6

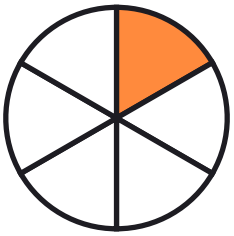

1/6

7



1/5

8



1/4