Name _____ Date _____

Fractions of shapes puzzle no. 12

What fraction of each shape is coloured in?

1



_____

2



_____

3



_____

4



_____

5



_____

6



_____

7



_____

8

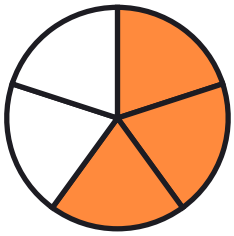

_____

Name _____ Date _____

Answer key: Fractions of shapes puzzle no. 12

What fraction of each shape is coloured in?

1



2/6

2



2/3

3



1/6

4



5/6

5



1/5

6



1/2

7



1/2

8

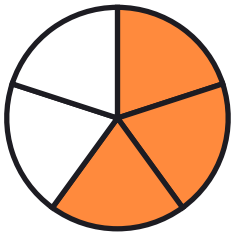

3/5