Name _____ Date _____

Fractions of shapes puzzle no. 14

What fraction of each shape is coloured in?

1



_____

2



_____

3



_____

4

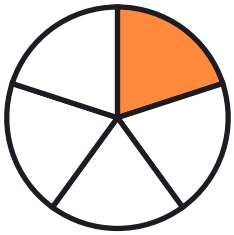

_____

5



_____

6



_____

7



_____

8



_____

Name _____ Date _____

Answer key: Fractions of shapes puzzle no. 14

What fraction of each shape is coloured in?

1



3/4

2



1/2

3



5/6

4

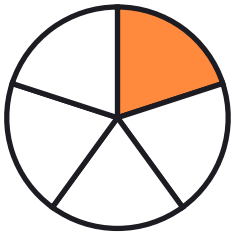

1/5

5



1/2

6



2/4

7



2/3

8



1/4