Name _____ Date _____

Fractions of shapes puzzle no. 15

What fraction of each shape is coloured in?

1



_____

2



_____

3

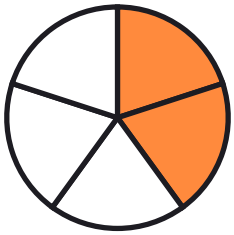

_____

4



_____

5



_____

6

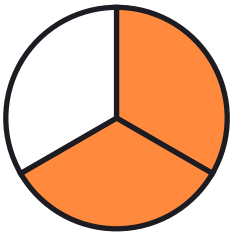

_____

7

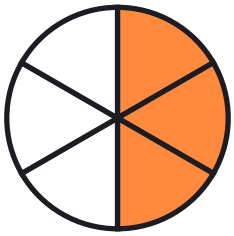

_____

8

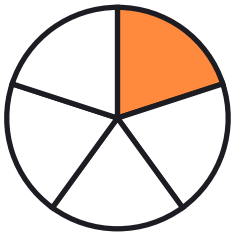

_____

Name _____ Date _____

Answer key: Fractions of shapes puzzle no. 15

What fraction of each shape is coloured in?

1



1/6

2



1/5

3

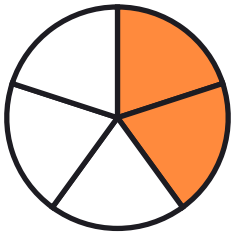

2/5

4



2/6

5



1/3

6

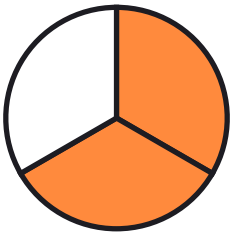

2/3

7

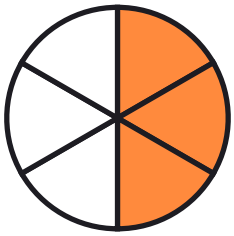

3/6

8

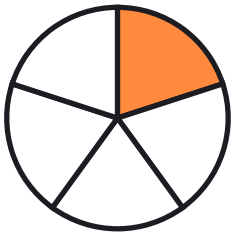

1/5