Name _____ Date _____

Fractions of shapes puzzle no. 16

What fraction of each shape is coloured in?

1



_____

2



_____

3



_____

4

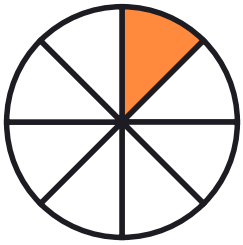

_____

5

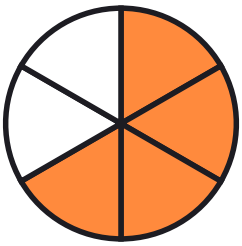

_____

6



_____

7



_____

8

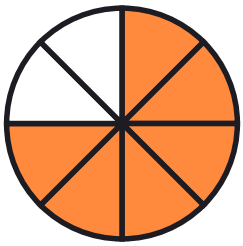

_____

Name _____ Date _____

Answer key: Fractions of shapes puzzle no. 16

What fraction of each shape is coloured in?

1



2/6

2



3/4

3



1/2

4

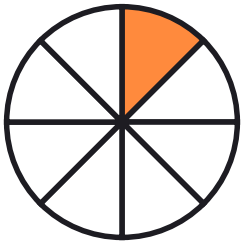

1/8

5

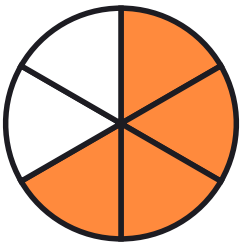

4/6

6



2/3

7



1/3

8

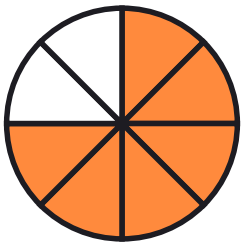

6/8