Name _____ Date _____

Fractions of shapes puzzle no. 18

What fraction of each shape is coloured in?

1



_____

2



_____

3



_____

4



_____

5

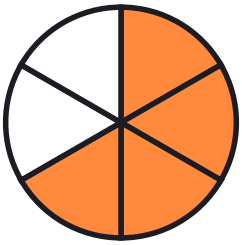

_____

6



_____

7



_____

8



_____

Name _____ Date _____

Answer key: Fractions of shapes puzzle no. 18

What fraction of each shape is coloured in?

1



1/5

2



5/8

3



3/8

4



3/6

5

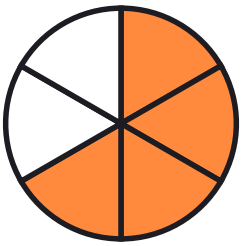

4/6

6



2/8

7



1/3

8



2/3