Name _____ Date _____

Fractions of shapes puzzle no. 19

What fraction of each shape is coloured in?

1



_____

2



_____

3



_____

4

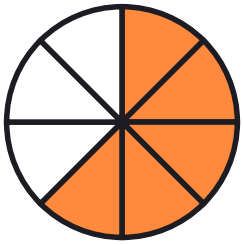

_____

5



_____

6



_____

7



_____

8



_____

Name _____ Date _____

Answer key: Fractions of shapes puzzle no. 19

What fraction of each shape is coloured in?

1



4/6

2



1/4

3



4/5

4

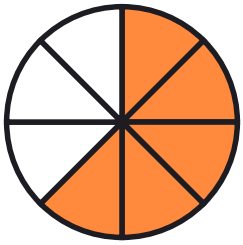

5/8

5



1/2

6



2/6

7



5/6

8



3/5