Name _____ Date _____

Fractions of shapes puzzle no. 20

What fraction of each shape is coloured in?

1

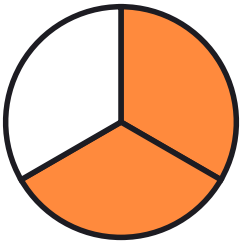

_____

2



_____

3

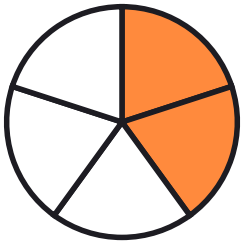

_____

4



_____

5



_____

6



_____

7



_____

8

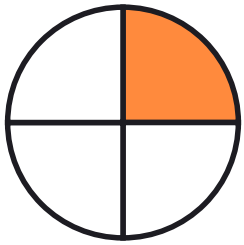

_____

Name _____ Date _____

Answer key: Fractions of shapes puzzle no. 20

What fraction of each shape is coloured in?

1

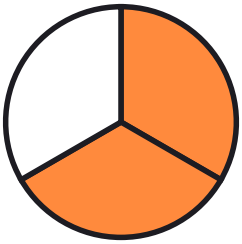

2/3

2



1/3

3

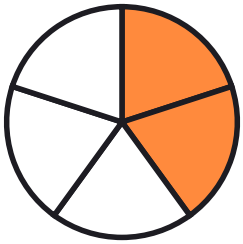

2/5

4



3/5

5



1/2

6



3/4

7



4/5

8

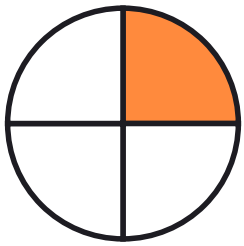

1/4