Name _____ Date _____

Fractions of shapes puzzle no. 3

What fraction of each shape is coloured in?

1



_____

2



_____

3



_____

4



_____

5

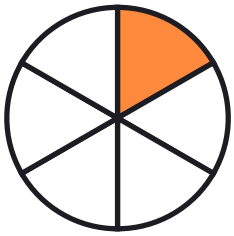

_____

6



_____

7

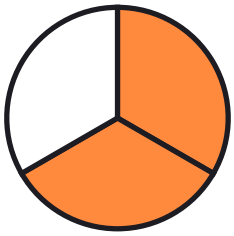

_____

8

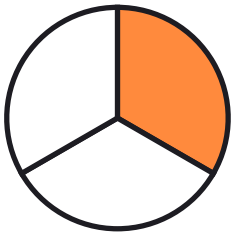

_____

Name _____ Date _____

Answer key: Fractions of shapes puzzle no. 3

What fraction of each shape is coloured in?

1



4/8

2



3/6

3



1/5

4



4/5

5

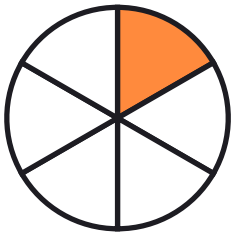

1/6

6



2/6

7

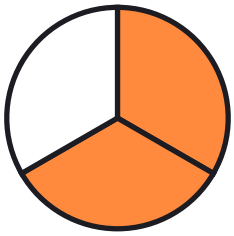

2/3

8

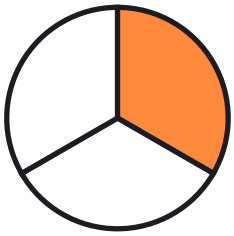

1/3