Name _____ Date _____

Fractions of shapes puzzle no. 4

What fraction of each shape is coloured in?

1



_____

2



_____

3



_____

4



_____

5



_____

6



_____

7



_____

8

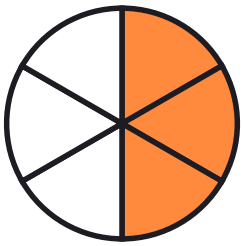

_____

Name _____ Date _____

Answer key: Fractions of shapes puzzle no. 4

What fraction of each shape is coloured in?

1



2/6

2



1/2

3



7/8

4



4/5

5



2/3

6



3/4

7



1/6

8

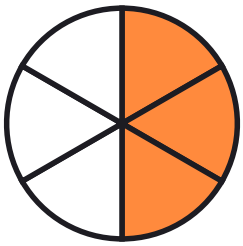

3/6