Name _____ Date _____

Fractions of shapes puzzle no. 5

What fraction of each shape is coloured in?

1

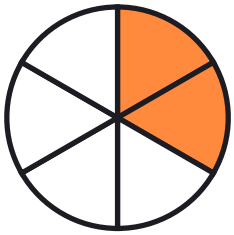

_____

2

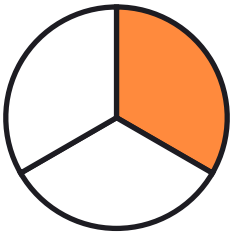

_____

3

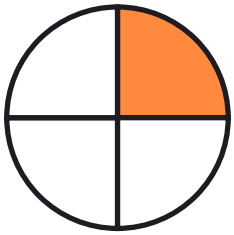

_____

4



_____

5



_____

6

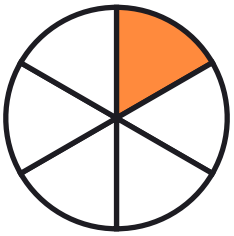

_____

7

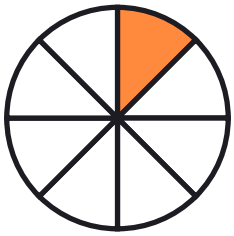

_____

8



_____

Name _____ Date _____

Answer key: Fractions of shapes puzzle no. 5

What fraction of each shape is coloured in?

1

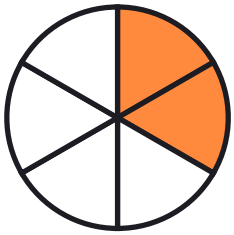

2/6

2

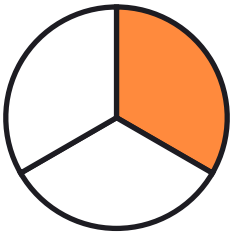

1/3

3

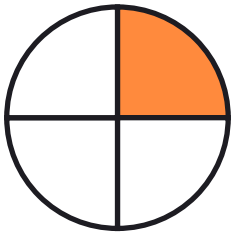

1/4

4



3/4

5



4/5

6

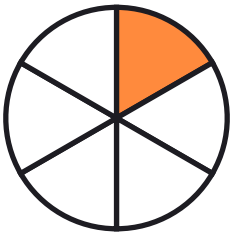

1/6

7

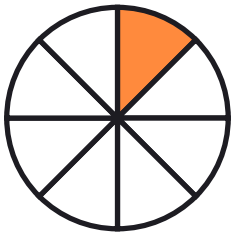

1/8

8



1/2