Name _____ Date _____

Fractions of shapes puzzle no. 7

What fraction of each shape is coloured in?

1



_____

2



_____

3

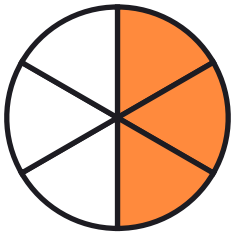

_____

4

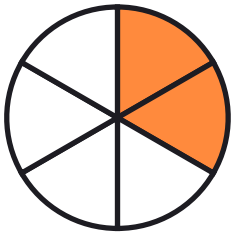

_____

5

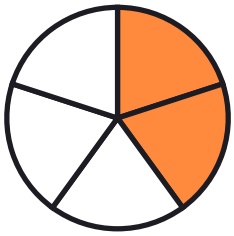

_____

6



_____

7



_____

8



_____

Name _____ Date _____

Answer key: Fractions of shapes puzzle no. 7

What fraction of each shape is coloured in?

1



1/2

2



4/5

3

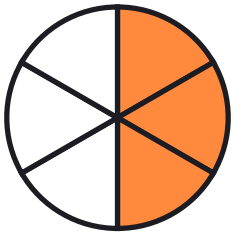

3/6

4

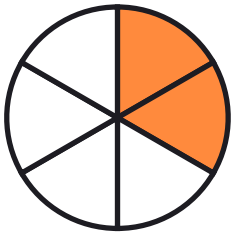

2/6

5

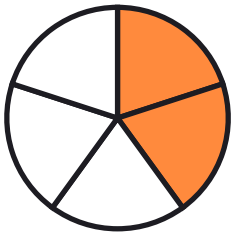

2/5

6



2/3

7



1/2

8



1/4