Name _____ Date _____

Fractions of shapes puzzle no. 8

What fraction of each shape is coloured in?

1



_____

2



_____

3



_____

4



_____

5



_____

6



_____

7



_____

8



_____

Name _____ Date _____

Answer key: Fractions of shapes puzzle no. 8

What fraction of each shape is coloured in?

1



3/5

2



2/4

3



2/6

4



2/8

5



2/5

6



5/6

7



3/4

8



2/3