Name _____ Date _____

Fractions of shapes puzzle no. 9

What fraction of each shape is coloured in?

1



_____

2



_____

3



_____

4



_____

5



_____

6



_____

7



_____

8

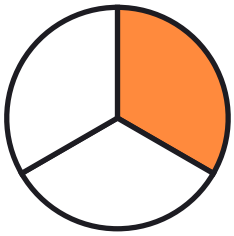

_____

Name _____ Date _____

Answer key: Fractions of shapes puzzle no. 9

What fraction of each shape is coloured in?

1



1/4

2



5/8

3



1/2

4



5/6

5



2/4

6



6/8

7



6/8

8

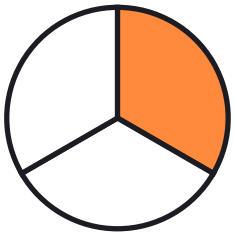

1/3