Name _____ Date _____

Fractions to twelfths puzzle no. 1

What fraction of each shape is coloured in?

1



_____

2



_____

3



_____

4



_____

5



_____

6



_____

7

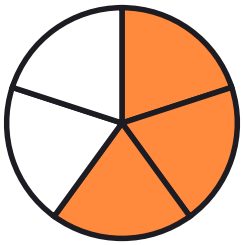

_____

8



_____

9



_____

10



_____

Name _____ Date _____

Answer key: Fractions to twelfths puzzle no. 1

What fraction of each shape is coloured in?

1



2/4

2



7/10

3



3/12

4



2/4

5



11/12

6



5/6

7

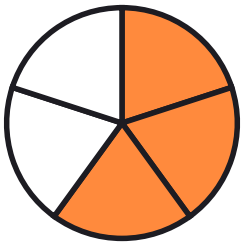

3/5

8



2/4

9



5/10

10



3/5