Name _____ Date _____

Fractions to twelfths puzzle no. 10

What fraction of each shape is coloured in?

1



_____

2



_____

3



_____

4



_____

5



_____

6



_____

7



_____

8

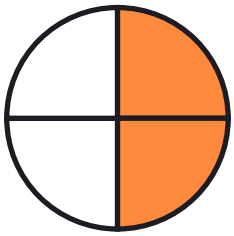

_____

9

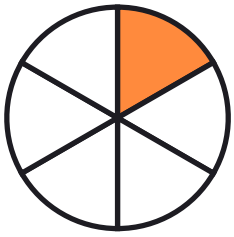

_____

10

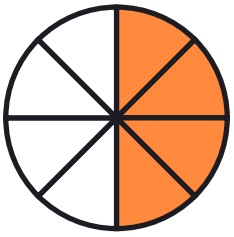

_____

Name _____ Date _____

Answer key: Fractions to twelfths puzzle no. 10

What fraction of each shape is coloured in?

1



1/6

2



7/10

3



4/6

4



2/10

5



5/12

6



5/10

7



8/12

8

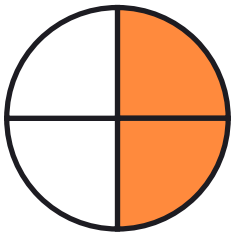

2/4

9

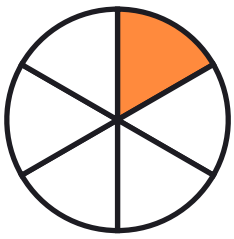

1/6

10

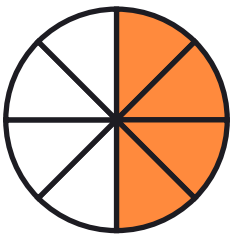

4/8