Name _____ Date _____

Fractions to twelfths puzzle no. 11

What fraction of each shape is coloured in?

1



_____

2

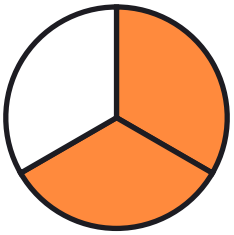

_____

3



_____

4



_____

5

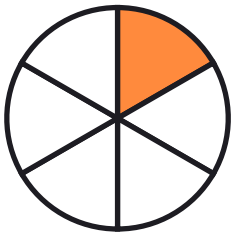

_____

6



_____

7

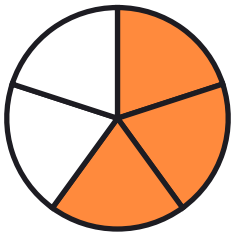

_____

8



_____

9



_____

10



_____

Name _____ Date _____

Answer key: Fractions to twelfths puzzle no. 11

What fraction of each shape is coloured in?

1



1/5

2

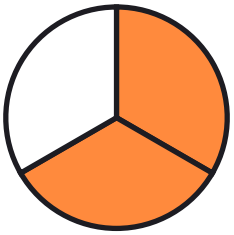

2/3

3



11/12

4



3/8

5

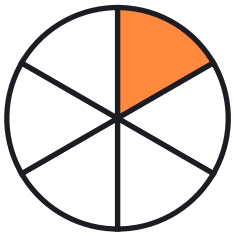

1/6

6



4/10

7

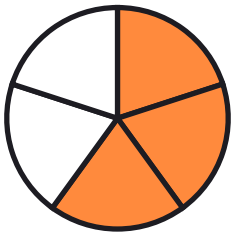

3/5

8



11/12

9



1/3

10



3/4