Name _____ Date _____

Fractions to twelfths puzzle no. 12

What fraction of each shape is coloured in?

1

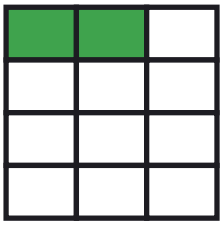

_____

2



_____

3



_____

4



_____

5



_____

6



_____

7



_____

8



_____

9



_____

10



_____

Name _____ Date _____

Answer key: Fractions to twelfths puzzle no. 12

What fraction of each shape is coloured in?

1

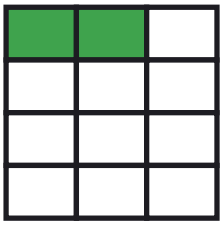

2/12

2



1/10

3



2/3

4



2/4

5



1/6

6



4/6

7



5/10

8



6/8

9



2/5

10



5/8