Name _____ Date _____

# Fractions to twelfths puzzle no. 13

What fraction of each shape is coloured in?

1



_____

2



_____

3



_____

4



_____

5

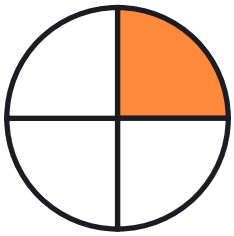

_____

6

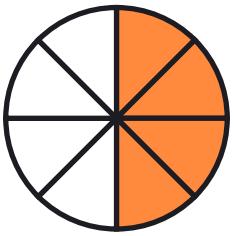

_____

7



_____

8



_____

9



_____

10



_____

Name _____ Date _____

# Answer key: Fractions to twelfths puzzle no. 13

What fraction of each shape is coloured in?

1



5/8

2



2/5

3

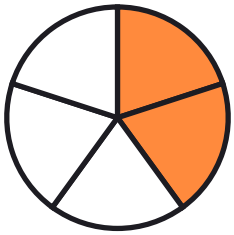

2/5

4



5/12

5

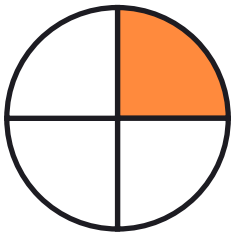

1/4

6

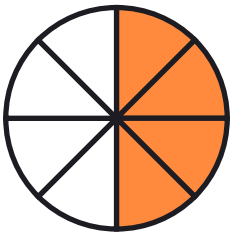

4/8

7



3/5

8



3/6

9



4/8

10



3/6