Name _____ Date _____

Fractions to twelfths puzzle no. 14

What fraction of each shape is coloured in?

1



_____

2



_____

3



_____

4

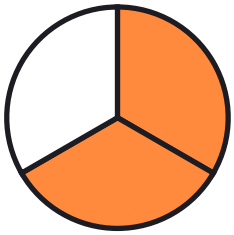

_____

5



_____

6



_____

7



_____

8



_____

9



_____

10



_____

Name _____ Date _____

Answer key: Fractions to twelfths puzzle no. 14

What fraction of each shape is coloured in?

1



4/8

2



7/8

3



2/8

4

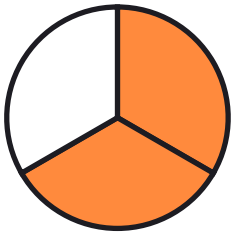

2/3

5



6/10

6



1/5

7



2/12

8



2/3

9



5/6

10



4/6