Name _____ Date _____

Fractions to twelfths puzzle no. 16

What fraction of each shape is coloured in?

1



_____

2

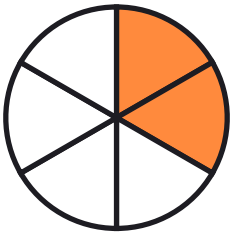

_____

3

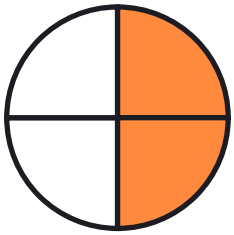

_____

4



_____

5



_____

6



_____

7



_____

8



_____

9



_____

10



_____

Name _____ Date _____

Answer key: Fractions to twelfths puzzle no. 16

What fraction of each shape is coloured in?

1



2/3

2

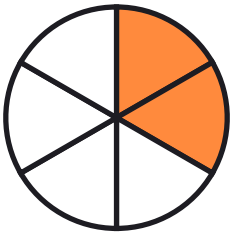

2/6

3

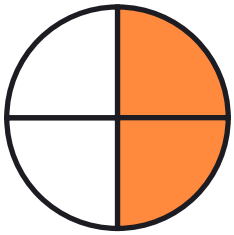

2/4

4



1/5

5



1/4

6



4/12

7



10/12

8



7/8

9



6/10

10



3/4