Name _____ Date _____

Fractions to twelfths puzzle no. 17

What fraction of each shape is coloured in?

1



_____

2

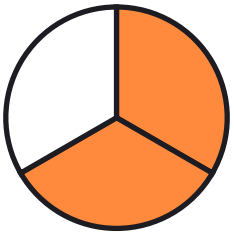

_____

3



_____

4



_____

5

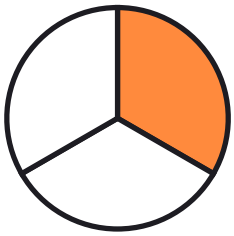

_____

6

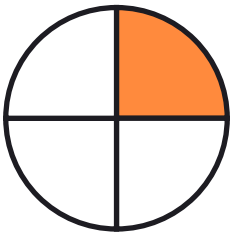

_____

7



_____

8

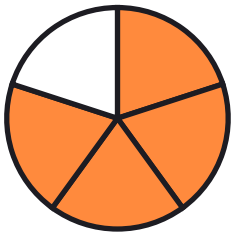

_____

9



_____

10

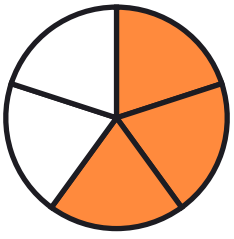

_____

Name _____ Date _____

Answer key: Fractions to twelfths puzzle no. 17

What fraction of each shape is coloured in?

1



9/10

2

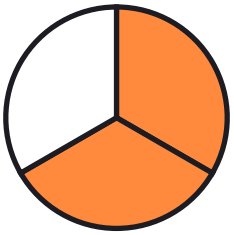

2/3

3



4/5

4



3/4

5

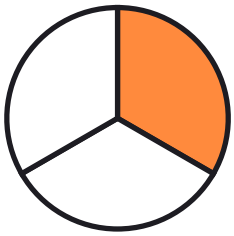

1/3

6

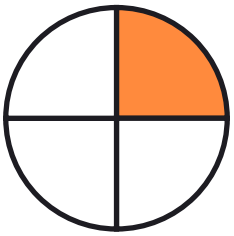

1/4

7



4/5

8

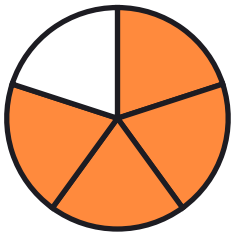

4/5

9



3/8

10

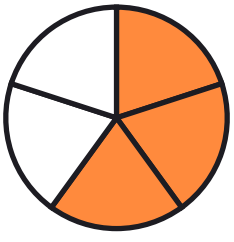

3/5