Name _____ Date _____

Fractions to twelfths puzzle no. 18

What fraction of each shape is coloured in?

1



_____

2

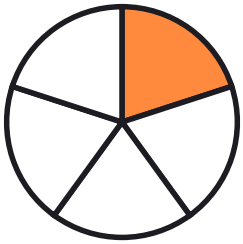

_____

3



_____

4



_____

5



_____

6



_____

7



_____

8



_____

9



_____

10



_____

Name _____ Date _____

Answer key: Fractions to twelfths puzzle no. 18

What fraction of each shape is coloured in?

1



7/8

2

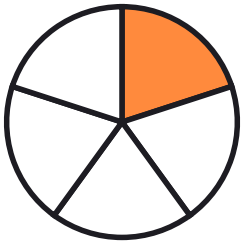

1/5

3



7/10

4



4/5

5



6/8

6



8/10

7



2/3

8



4/12

9



6/8

10



1/5