Name _____ Date _____

Fractions to twelfths puzzle no. 19

What fraction of each shape is coloured in?

1



_____

2



_____

3



_____

4



_____

5



_____

6

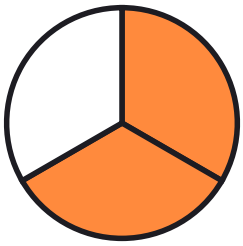

_____

7



_____

8



_____

9



_____

10

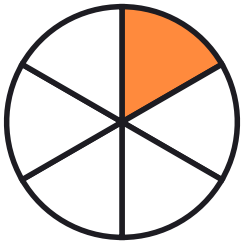

_____

Name _____ Date _____

Answer key: Fractions to twelfths puzzle no. 19

What fraction of each shape is coloured in?

1



2/6

2



6/12

3



1/3

4



2/3

5



1/5

6

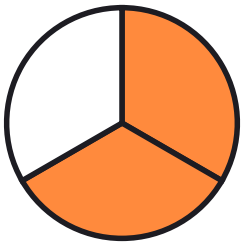

2/3

7



5/8

8



3/8

9



3/6

10

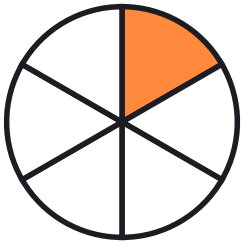

1/6