Name _____ Date _____

Fractions to twelfths puzzle no. 20

What fraction of each shape is coloured in?

1

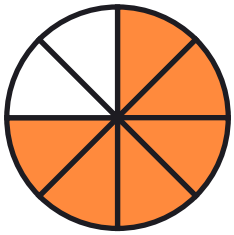

_____

2



_____

3



_____

4



_____

5



_____

6



_____

7



_____

8

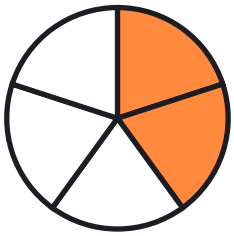

_____

9



_____

10



_____

Name _____ Date _____

Answer key: Fractions to twelfths puzzle no. 20

What fraction of each shape is coloured in?

1

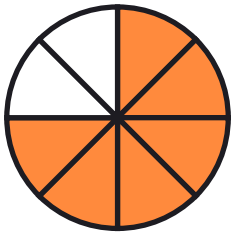

6/8

2



1/3

3



7/10

4



5/12

5



3/5

6



2/3

7



2/12

8

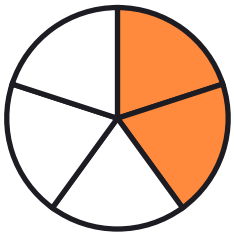

2/5

9



2/5

10



8/10