Name _____ Date _____

Fractions to twelfths puzzle no. 3

What fraction of each shape is coloured in?

1

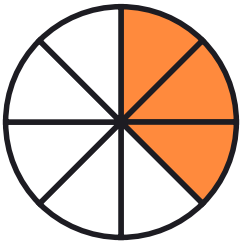

_____

2



_____

3



_____

4



_____

5

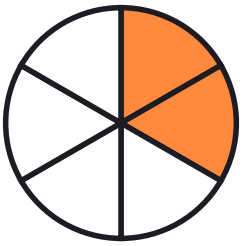

_____

6



_____

7



_____

8



_____

9

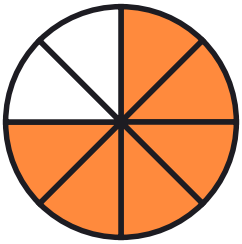

_____

10



_____

Name _____ Date _____

Answer key: Fractions to twelfths puzzle no. 3

What fraction of each shape is coloured in?

1

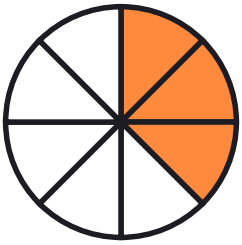

3/8

2



4/10

3



1/5

4



1/10

5

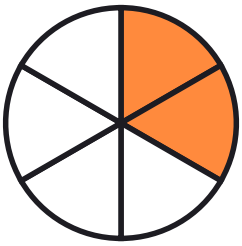

2/6

6



7/10

7



4/6

8



3/8

9

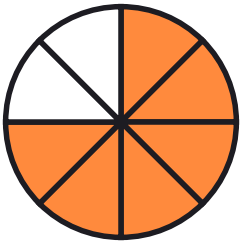

6/8

10



7/8