Name _____ Date _____

Fractions to twelfths puzzle no. 4

What fraction of each shape is coloured in?

1



_____

2



_____

3



_____

4



_____

5



_____

6



_____

7



_____

8



_____

9

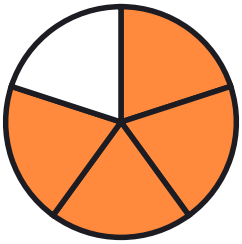

_____

10



_____

Name _____ Date _____

Answer key: Fractions to twelfths puzzle no. 4

What fraction of each shape is coloured in?

1



1/3

2



1/4

3



3/4

4



3/6

5



2/4

6



1/3

7



8/10

8



1/10

9

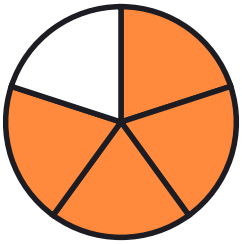

4/5

10



7/12