Name _____ Date _____

Fractions to twelfths puzzle no. 5

What fraction of each shape is coloured in?

1

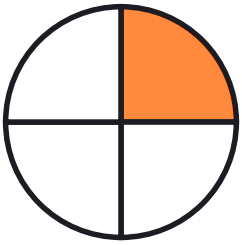

_____

2



_____

3



_____

4

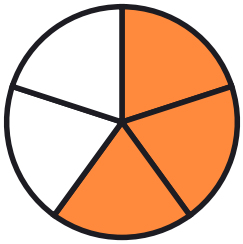

_____

5



_____

6



_____

7

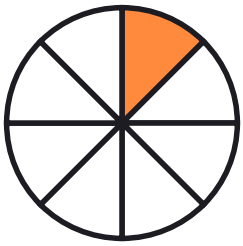

_____

8



_____

9



_____

10

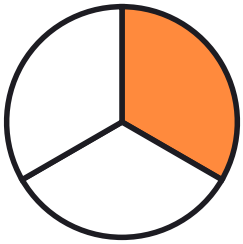

_____

Name _____ Date _____

Answer key: Fractions to twelfths puzzle no. 5

What fraction of each shape is coloured in?

1

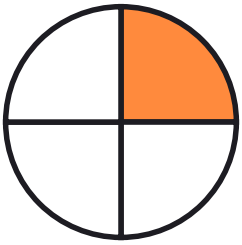

1/4

2



1/12

3



8/10

4

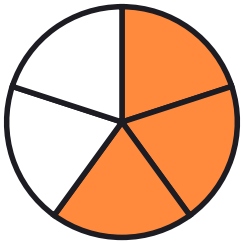

3/5

5



9/12

6



2/4

7

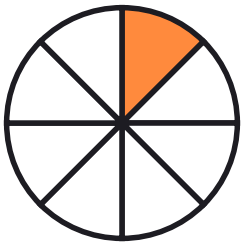

1/8

8



1/3

9



1/5

10

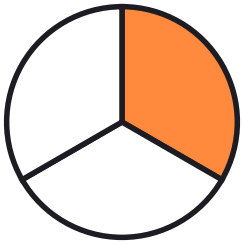

1/3