Name _____ Date _____

Fractions to twelfths puzzle no. 6

What fraction of each shape is coloured in?

1

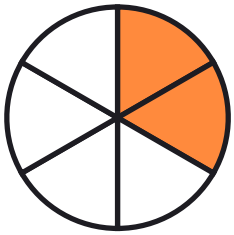

_____

2



_____

3



_____

4



_____

5



_____

6



_____

7

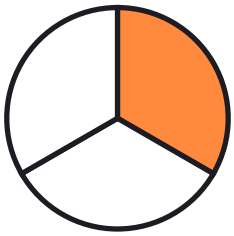

_____

8



_____

9



_____

10



_____

Name _____ Date _____

Answer key: Fractions to twelfths puzzle no. 6

What fraction of each shape is coloured in?

1

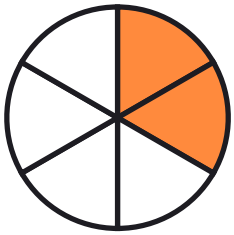

2/6

2



2/3

3



9/10

4



2/10

5



9/12

6



2/6

7

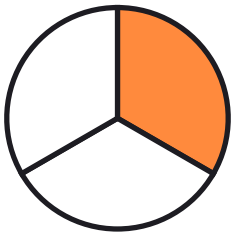

1/3

8



3/4

9



2/8

10



7/10