Name _____ Date _____

Fractions to twelfths puzzle no. 7

What fraction of each shape is coloured in?

1



_____

2



_____

3



_____

4

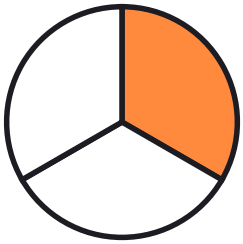

_____

5



_____

6



_____

7



_____

8

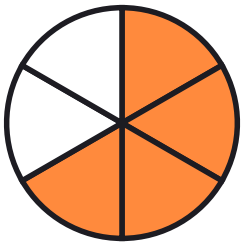

_____

9



_____

10

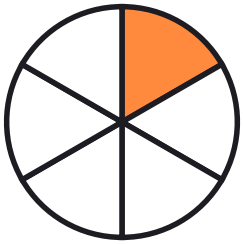

_____

Name _____ Date _____

Answer key: Fractions to twelfths puzzle no. 7

What fraction of each shape is coloured in?

1



7/10

2



5/8

3



3/6

4

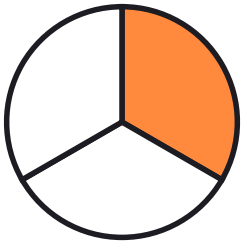

1/3

5



2/4

6



2/5

7



2/8

8

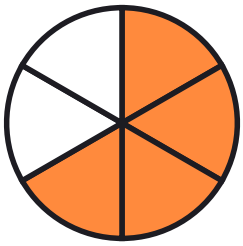

4/6

9



5/8

10

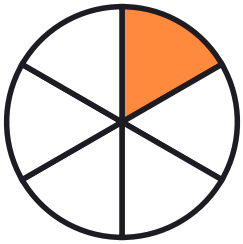

1/6