Name _____ Date _____

Fractions to twelfths puzzle no. 8

What fraction of each shape is coloured in?

1



_____

2



_____

3



_____

4

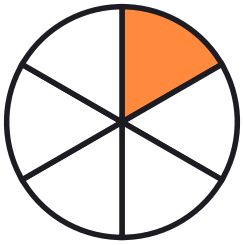

_____

5



_____

6

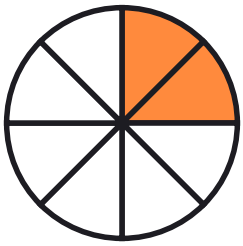

_____

7



_____

8



_____

9



_____

10



_____

Name _____ Date _____

Answer key: Fractions to twelfths puzzle no. 8

What fraction of each shape is coloured in?

1



3/4

2



4/10

3



3/5

4

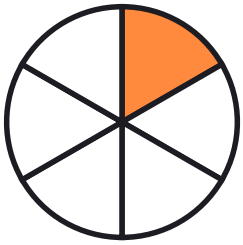

1/6

5



2/4

6

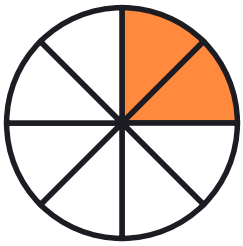

2/8

7



1/3

8



2/8

9



8/10

10



1/4