Name _____ Date _____

Fractions to twelfths puzzle no. 9

What fraction of each shape is coloured in?

1



_____

2



_____

3



_____

4



_____

5



_____

6



_____

7



_____

8



_____

9



_____

10



_____

Name _____ Date _____

Answer key: Fractions to twelfths puzzle no. 9

What fraction of each shape is coloured in?

1



3/4

2



2/8

3



5/12

4



7/8

5



9/10

6



2/8

7



3/8

8



9/12

9



1/6

10



4/10