Name _____ Date _____

Halves and quarters puzzle no. 17

What fraction of each shape is coloured in? Write it like 1/2.

1



_____

2



_____

3



_____

4

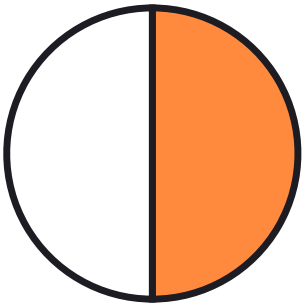

_____

5

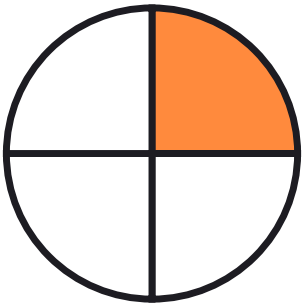

_____

6



_____

Name _____ Date _____

Answer key: Halves and quarters puzzle no. 17

What fraction of each shape is coloured in? Write it like 1/2.

1



1/2

2



1/2

3



1/4

4

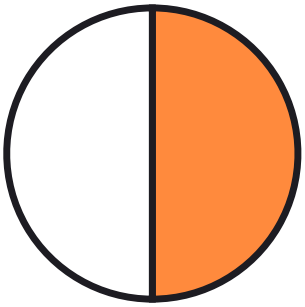

1/2

5

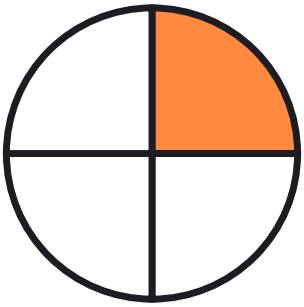

1/4

6



2/4