Name _____ Date _____

Halves and quarters puzzle no. 19

What fraction of each shape is coloured in? Write it like 1/2.

1



_____

2



_____

3



_____

4

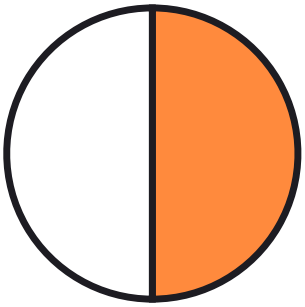

_____

5



_____

6



_____

Name _____ Date _____

Answer key: Halves and quarters puzzle no. 19

What fraction of each shape is coloured in? Write it like 1/2.

1



2/4

2



2/4

3



3/4

4

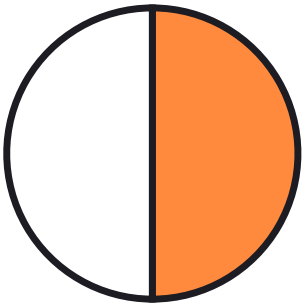

1/2

5



2/4

6



1/4