Name _____ Date _____

Halves, thirds and quarters puzzle no. 11

What fraction of each shape is coloured in?

1



_____

2



_____

3

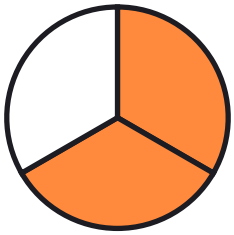

_____

4



_____

5

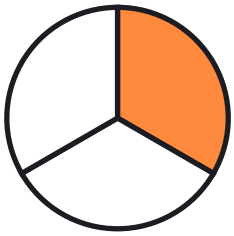

_____

6



_____

7



_____

8



_____

Name _____ Date _____

Answer key: Halves, thirds and quarters puzzle no. 11

What fraction of each shape is coloured in?

1



1/2

2



1/2

3

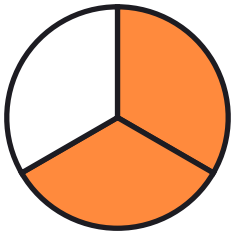

2/3

4



2/3

5

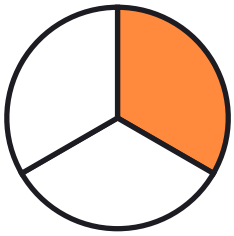

1/3

6



1/4

7



3/4

8



2/3