Name _____ Date _____

Halves, thirds and quarters puzzle no. 12

What fraction of each shape is coloured in?

1

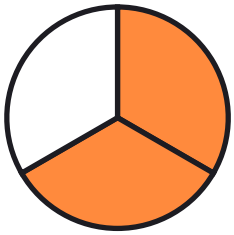

_____

2

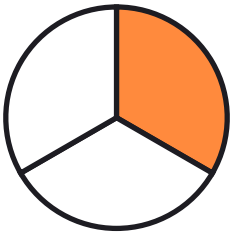

_____

3



_____

4



_____

5



_____

6



_____

7



_____

8



_____

Name _____ Date _____

Answer key: Halves, thirds and quarters puzzle no. 12

What fraction of each shape is coloured in?

1

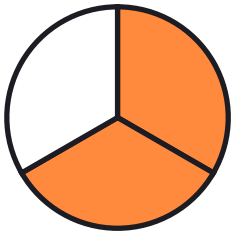

2/3

2

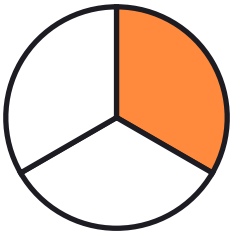

1/3

3



1/2

4



1/4

5



1/4

6



1/2

7



3/4

8



2/4