Name _____ Date _____

Halves, thirds and quarters puzzle no. 17

What fraction of each shape is coloured in?

1

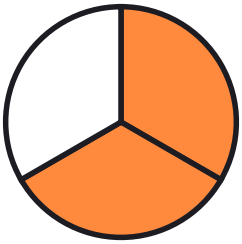

_____

2



_____

3



_____

4

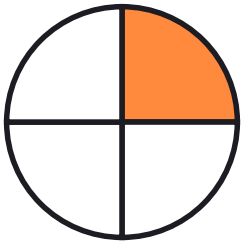

_____

5



_____

6

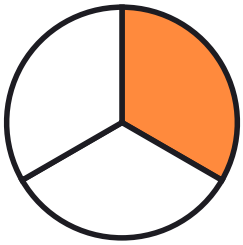

_____

7



_____

8

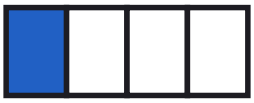

_____

Name _____ Date _____

Answer key: Halves, thirds and quarters puzzle no. 17

What fraction of each shape is coloured in?

1

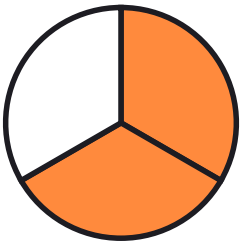

2/3

2



1/2

3



3/4

4

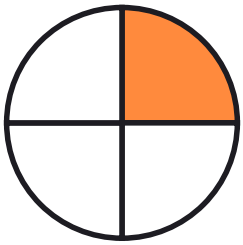

1/4

5



1/2

6

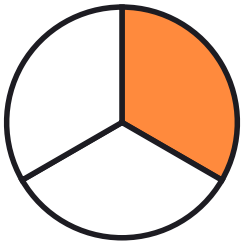

1/3

7



2/4

8



1/4