Name _____ Date _____

Halves, thirds and quarters puzzle no. 2

What fraction of each shape is coloured in?

1



_____

2



_____

3



_____

4



_____

5

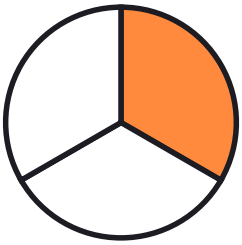

_____

6



_____

7



_____

8



_____

Name _____ Date _____

Answer key: Halves, thirds and quarters puzzle no. 2

What fraction of each shape is coloured in?

1



1/4

2



1/2

3



1/2

4



3/4

5

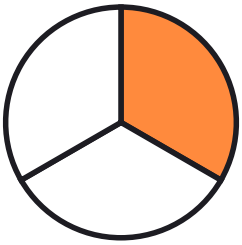

1/3

6



1/3

7



2/4

8



2/4