Name _____ Date _____

Halves, thirds and quarters puzzle no. 20

What fraction of each shape is coloured in?

1



_____

2



_____

3



_____

4



_____

5



_____

6

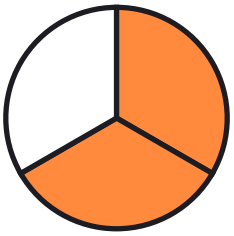

_____

7



_____

8



_____

Name _____ Date _____

Answer key: Halves, thirds and quarters puzzle no. 20

What fraction of each shape is coloured in?

1



1/2

2



1/3

3



2/4

4



1/4

5



1/2

6

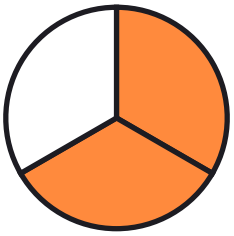

2/3

7



2/3

8



1/2