Name _____ Date _____

Halves, thirds and quarters puzzle no. 3

What fraction of each shape is coloured in?

1



_____

2



_____

3



_____

4



_____

5



_____

6

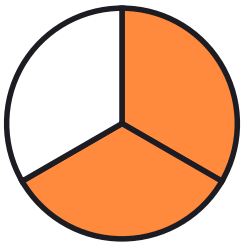

_____

7



_____

8



_____

Name _____ Date _____

Answer key: Halves, thirds and quarters puzzle no. 3

What fraction of each shape is coloured in?

1



2/3

2



2/4

3



1/2

4



2/4

5



1/3

6

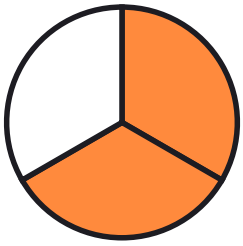

2/3

7



1/2

8



1/3