Name _____ Date _____

Halves, thirds and quarters puzzle no. 7

What fraction of each shape is coloured in?

1



_____

2



_____

3



_____

4



_____

5



_____

6



_____

7

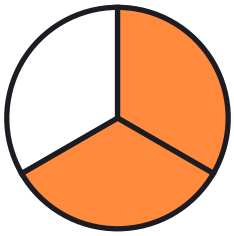

_____

8



_____

Name _____ Date _____

Answer key: Halves, thirds and quarters puzzle no. 7

What fraction of each shape is coloured in?

1



3/4

2



2/3

3



1/3

4



1/2

5



1/2

6



1/2

7

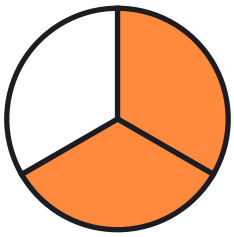

2/3

8



1/3