Name _____ Date _____

Bills and coins puzzle no. 1

Count the bills and coins. Write each total like $6.85.

1

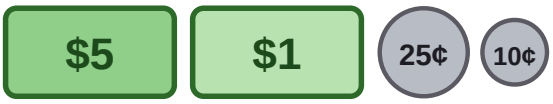

_____

2



_____

3



_____

4



_____

5



_____

6



_____

7



_____

8

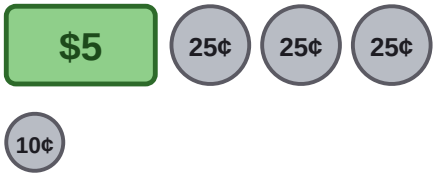

_____

9



_____

10



_____

Name _____ Date _____

Answer key: Bills and coins puzzle no. 1

Count the bills and coins. Write each total like $6.85.

1

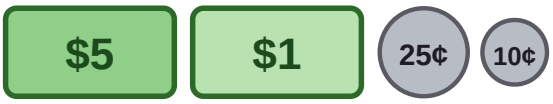

$6.35

2



$10.00

3



$6.15

4



$6.10

5



$6.40

6



$5.15

7



$7.20

8

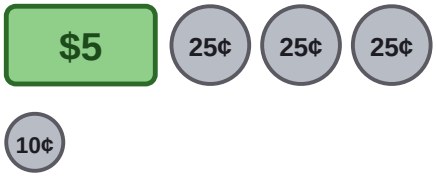

$5.85

9



$5.40

10



$5.50