Name _____ Date _____

Bills and coins puzzle no. 10

Count the bills and coins. Write each total like $6.85.

1

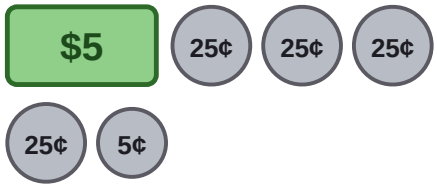

_____

2



_____

3



_____

4

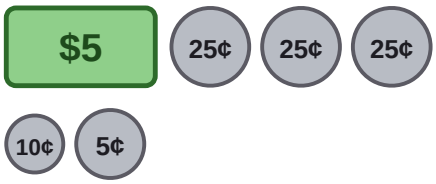

_____

5

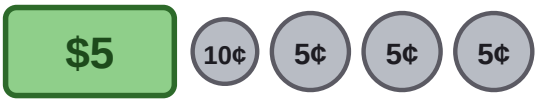

_____

6



_____

7



_____

8



_____

9

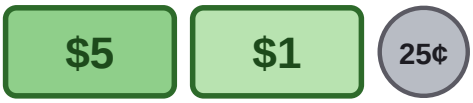

_____

10



_____

Name _____ Date _____

Answer key: Bills and coins puzzle no. 10

Count the bills and coins. Write each total like $6.85.

1

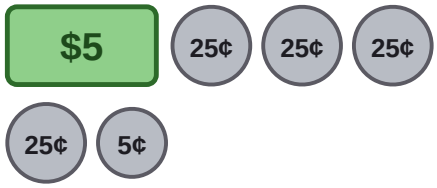

$6.05

2



$6.05

3



$6.50

4

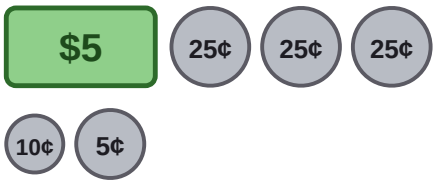

$5.90

5

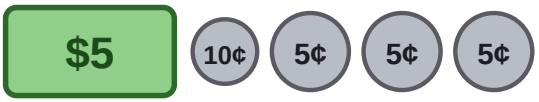

$5.25

6



$6.40

7



$10.00

8



$6.25

9

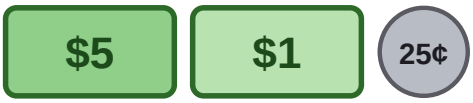

$6.25

10



$5.45