Name _____ Date _____

Bills and coins puzzle no. 11

Count the bills and coins. Write each total like $6.85.

1



_____

2

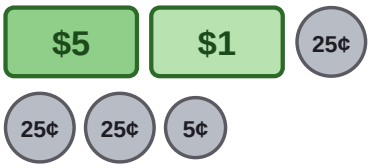

_____

3

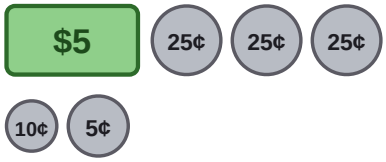

_____

4



_____

5

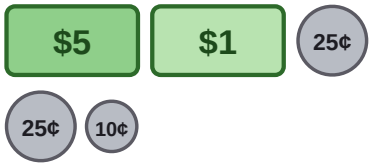

_____

6

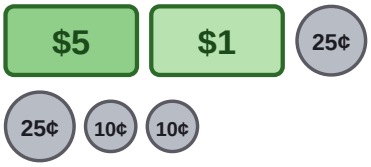

_____

7



_____

8



_____

9



_____

10



_____

Name _____ Date _____

Answer key: Bills and coins puzzle no. 11

Count the bills and coins. Write each total like $6.85.

1



$10.00

2

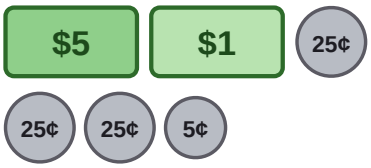

$6.80

3

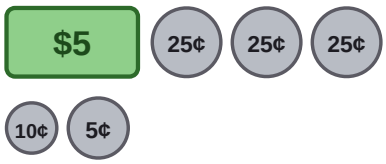

$5.90

4



$6.30

5

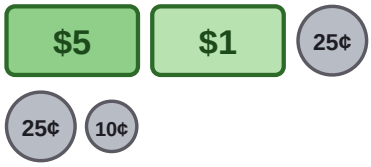

$6.60

6

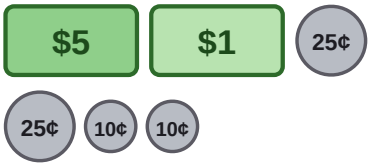

$6.70

7



$7.05

8



$5.35

9



$6.30

10



$6.20