Name _____ Date _____

Bills and coins puzzle no. 13

Count the bills and coins. Write each total like $6.85.

1



_____

2

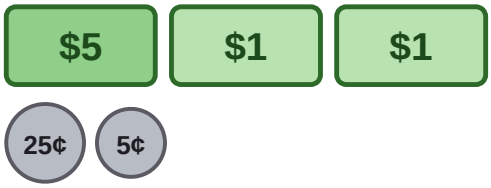

_____

3

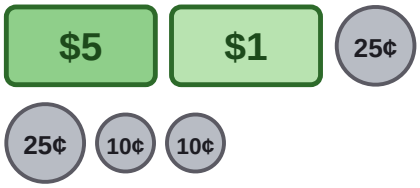

_____

4

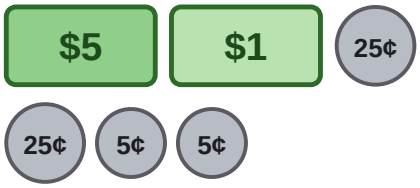

_____

5

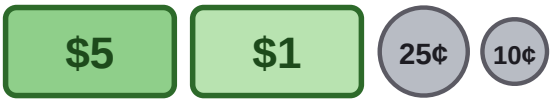

_____

6

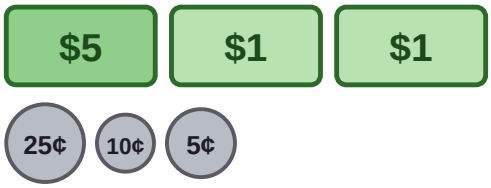

_____

7



_____

8



_____

9

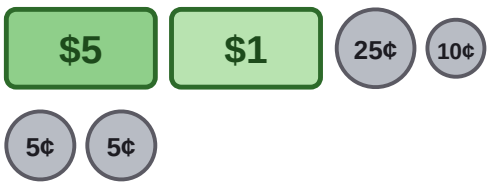

_____

10



_____

Name _____ Date _____

Answer key: Bills and coins puzzle no. 13

Count the bills and coins. Write each total like $6.85.

1



$10.00

2

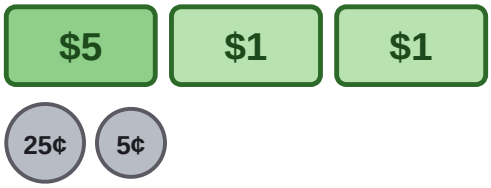

$7.30

3

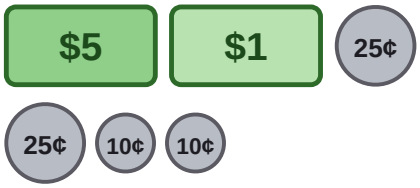

$6.70

4

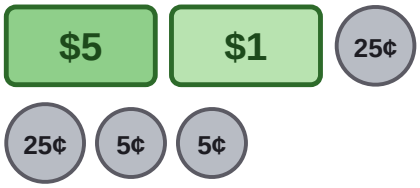

$6.60

5

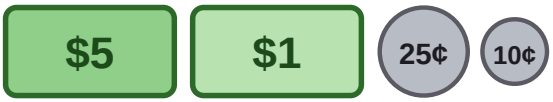

$6.35

6

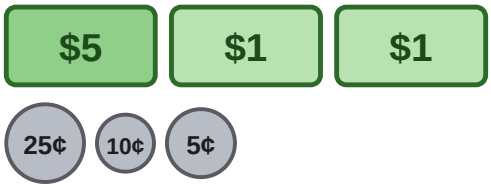

$7.40

7



$7.15

8



$8.00

9

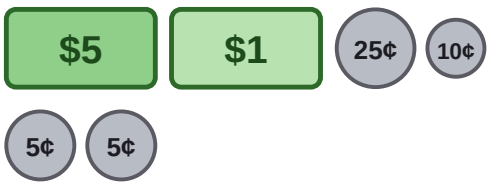

$6.45

10



$6.20