Name _____ Date _____

Bills and coins puzzle no. 14

Count the bills and coins. Write each total like $6.85.

1



_____

2

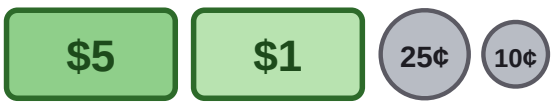

_____

3



_____

4



_____

5



_____

6



_____

7



_____

8



_____

9



_____

10

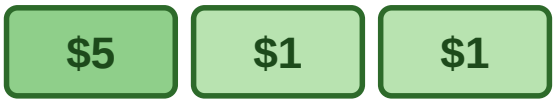

_____

Name _____ Date _____

Answer key: Bills and coins puzzle no. 14

Count the bills and coins. Write each total like $6.85.

1



$6.25

2

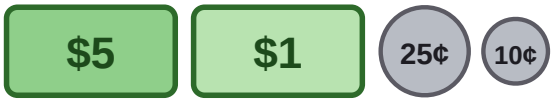

$6.35

3



$5.50

4



$6.20

5



$10.00

6



$5.45

7



$7.35

8



$5.30

9



$6.15

10

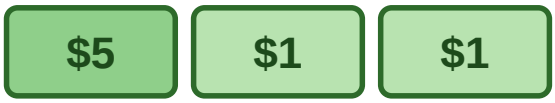

$7.00