Name _____ Date _____

Bills and coins puzzle no. 15

Count the bills and coins. Write each total like $6.85.

1

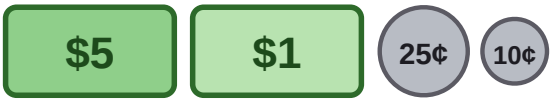

_____

2

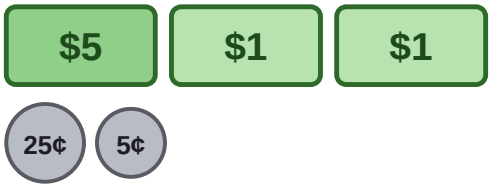

_____

3

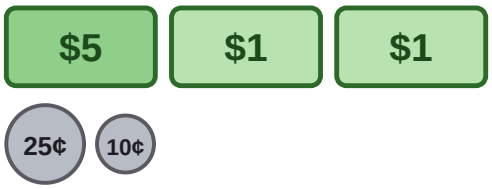

_____

4



_____

5

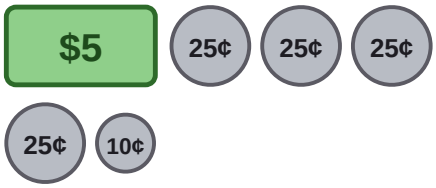

_____

6



_____

7



_____

8



_____

9



_____

10

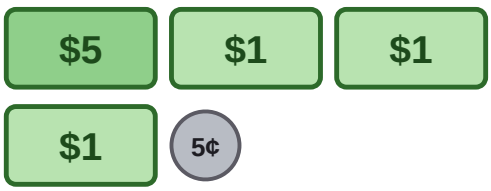

_____

Name _____ Date _____

Answer key: Bills and coins puzzle no. 15

Count the bills and coins. Write each total like $6.85.

1

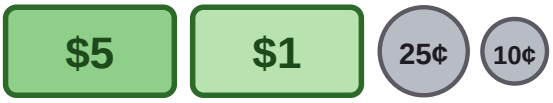

$6.35

2

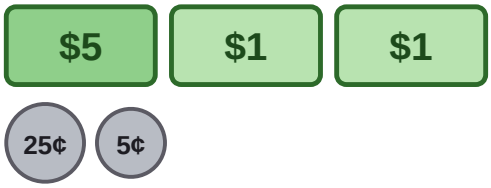

$7.30

3

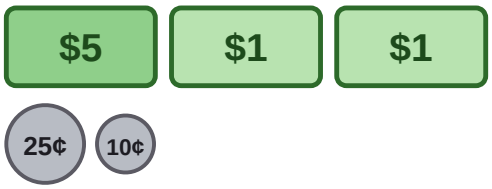

$7.35

4



$6.10

5

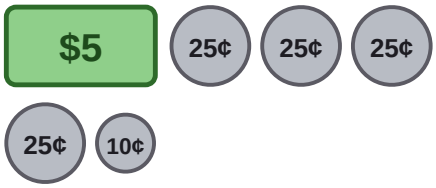

$6.10

6



$5.30

7



$5.60

8



$5.20

9



$10.00

10

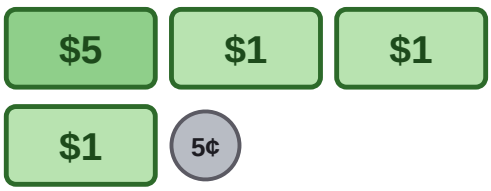

$8.05