Name _____ Date _____

Bills and coins puzzle no. 16

Count the bills and coins. Write each total like $6.85.

1



_____

2



_____

3



_____

4



_____

5



_____

6

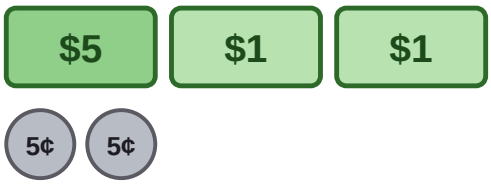

_____

7

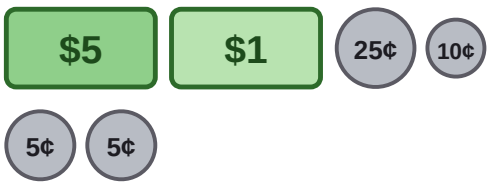

_____

8



_____

9

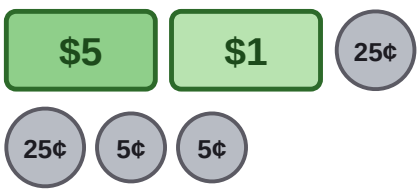

_____

10



_____

Name _____ Date _____

Answer key: Bills and coins puzzle no. 16

Count the bills and coins. Write each total like $6.85.

1



$5.10

2



$6.20

3



$7.05

4



$6.45

5



$10.00

6

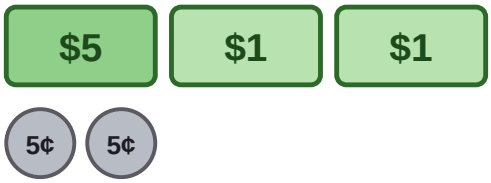

$7.10

7

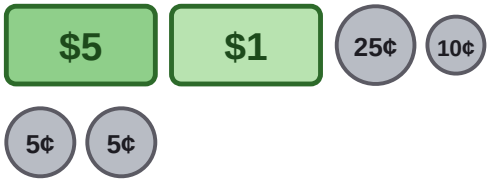

$6.45

8



$5.15

9

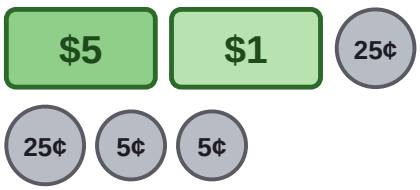

$6.60

10



$6.30